1) Measure the perimeter of each shape.

a)

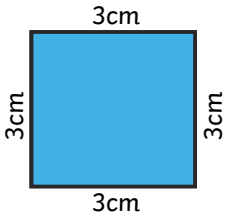

b)

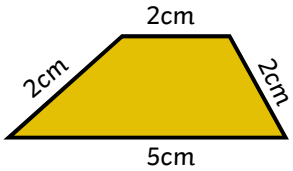

Shapes not to scale.

Perimeter =

Perimeter =

c)

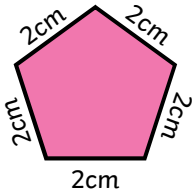

d)

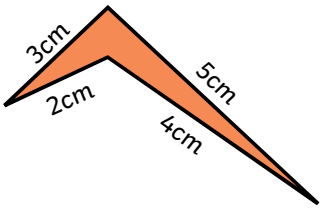

Shapes not to scale.

Perimeter =

Perimeter =

2) Measure the perimeter of each shape.

a)



b)

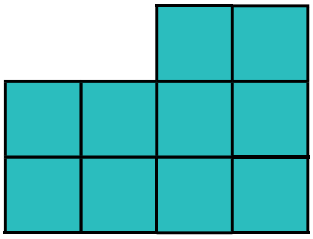

c)

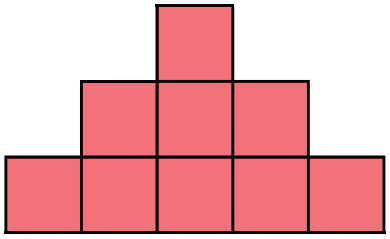

Perimeter =

Perimeter =

Perimeter =